Name: _____ Date: _____

COMPARING Numbers

Directions: Compare each set of numbers. Color the greater number.

251	252	975	983
114	193	516	412
876	856	28	32
636	649	711	701
415	405	289	398
96	89	228	238

© Busy Me Plus Three

Name: _____ Date: _____

ORDERING NUMBERS



Directions: Order the numbers from greatest to least.

459, 237, 376, 572	
624, 141, 985, 736	
274, 842, 419, 615	
58, 69, 71, 52	
114, 116, 112, 119	
740, 150, 140, 750	
525, 815, 679, 292	

© Busy Me Plus Three

Name: _____ Date: _____

SUMMER SUBTRACTION

Directions: Find the missing numbers in the subtraction problems. The first one is done for you.



17 - 3 = 14



_____ - _____ = 9

11 - _____ = _____



_____ - 6 = _____

_____ - 9 = _____

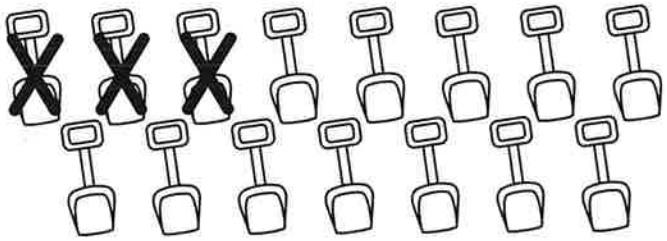

_____ - _____ = 12



_____ - _____ = 10

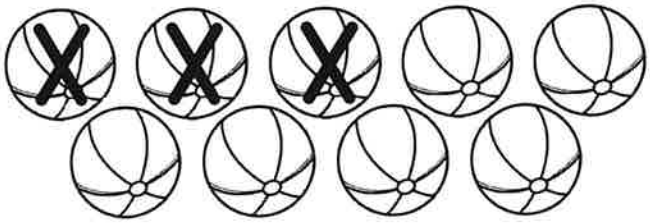

9 - _____ = _____

© Busy Me Plus Three

Name: _____ Date: _____

NUMBER SURFING



Directions: Write 100 less than the number shown on the left, and 100 more than the number shown on the right.

445	259
166	523
872	604
317	761

© Busy Me Plus Three

Name: _____ Date: _____



POPSICLE Addition

Directions: Add the numbers. Color the popsicle yellow if it is odd and blue if it is even.

19 + 93 =	94 + 13 =	18 + 16 =	33 + 47 =	56 + 61 =
39 + 25 =	71 + 44 =	77 + 37 =	48 + 15 =	29 + 27 =
53 + 93 =	26 + 57 =	73 + 82 =	68 + 25 =	88 + 82 =

© Busy Me Plus Three

Name: _____ Date: _____

POPSICLE SUBTRACTION



Directions: Subtract the numbers. Color the popsicle pink if it is odd and green if it is even.

98 − 34 =	75 − 28 =	76 − 47 =	92 − 55 =	89 − 66 =
80 − 46 =	66 − 18 =	97 − 53 =	82 − 23 =	44 − 13 =
73 − 65 =	85 − 52 =	61 − 15 =	68 − 36 =	95 − 23 =

© Busy Me Plus Three

Name: _____ Date: _____

Splash of NUMBERS!

Directions: Show how to represent each number in the different forms below.

	TENS	ONES	EXPANDED FORM	BASE TEN BLOCKS
25				
91				
78				
40				
62				
37				
84				

© Busy Me Plus Three

Name: _____ Date: _____

BEACH DAY SHOPPING

Directions: Look at how much each item costs. Color in that amount of coins.

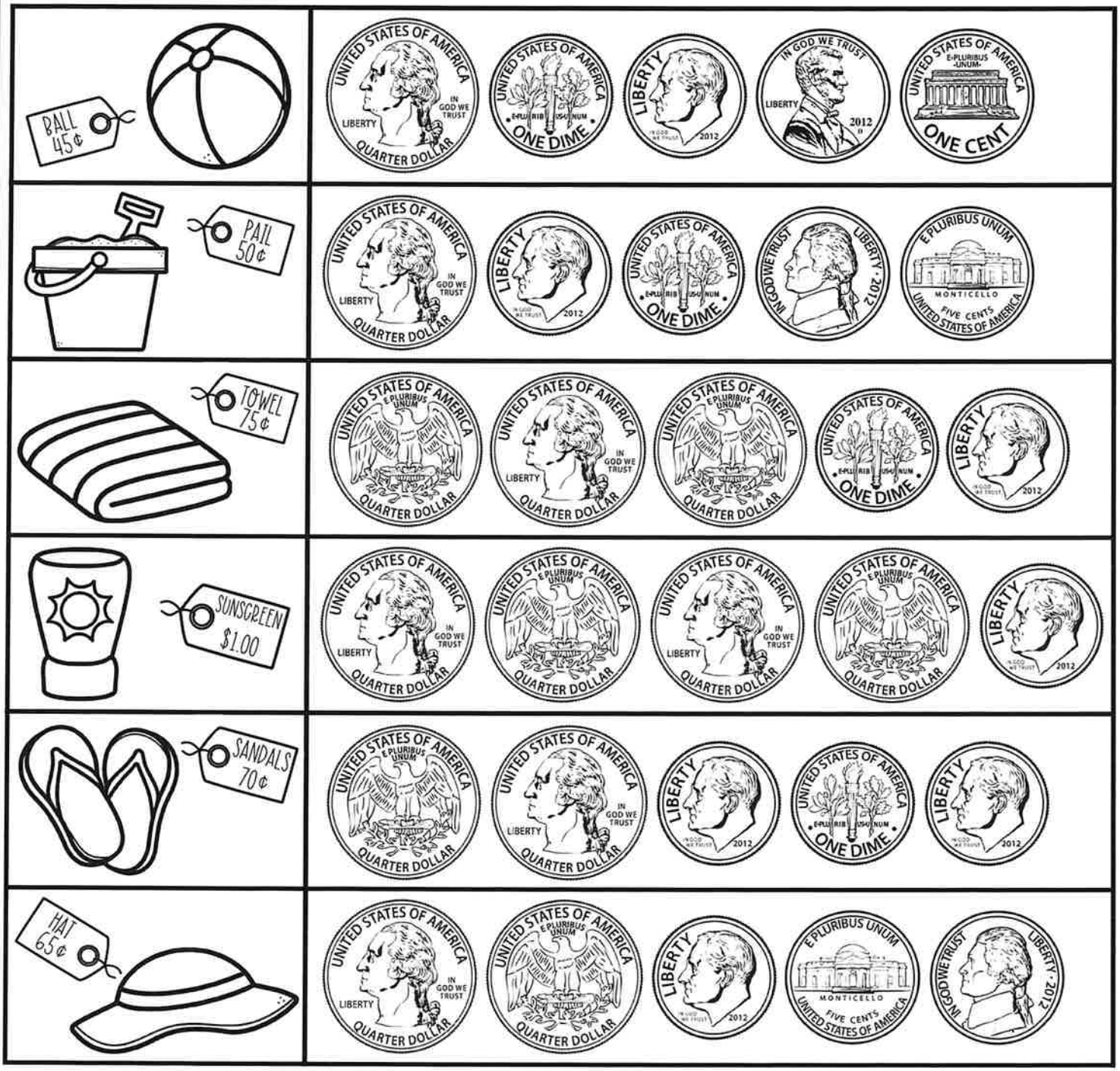

© Busy Me Plus Three